Bar charts

To achieve the expected standard, you need to:
★ complete, read and interpret information presented in **bar charts**.

1 This bar chart shows the types of library books borrowed by Class 6 last term.

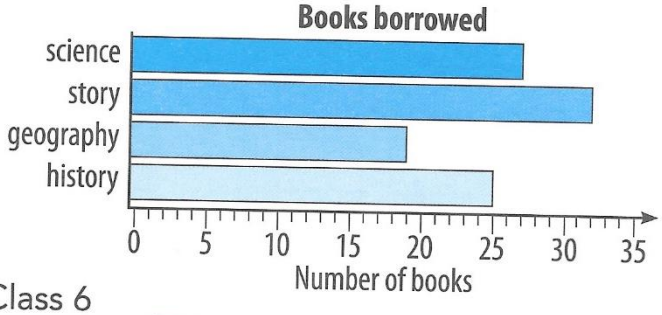

a) How many **more** story books than geography books were borrowed? ☐ 1a (1 mark)

b) How many books did Class 6 borrow in **total** from the library? ☐ 1b (1 mark)

2 This bar chart shows the mass of different objects.

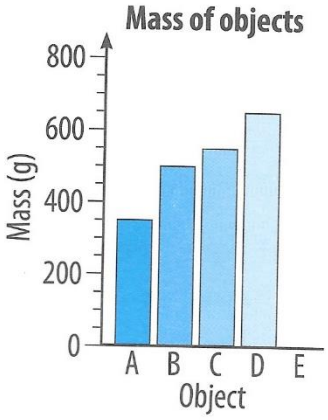

a) Complete the table using the bar chart to help you. ☐ 2a (1 mark)

	Object A	Object B	Object C	Object D
Mass (g)				

b) Object E has a mass of 450 g. Draw the missing bar on the chart. ☐ 2b (1 mark)

3 This bar chart shows the money raised by each class in a cake sale.

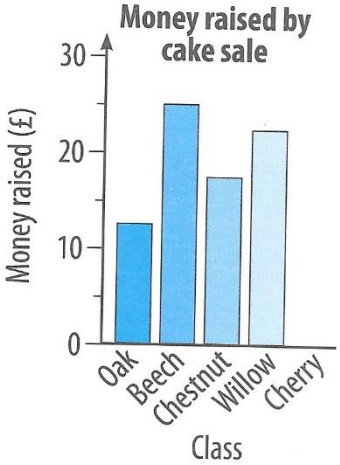

a) How many classes raised **more** than £20? ☐ 3a (1 mark)

b) Cherry Class raised £1.25 **less than** Oak Class. Draw the missing bar on the chart. ☐ 3b (1 mark)

c) The school cake sale target was **£100 altogether**.

How much **more** money did they need to raise to reach the target? ☐ 3c (2 marks)

Top tip

- Look at the scale to see what each interval represents.

/8 Total for this page